DELHI PUBLIC SCHOOL

Monthly Assignment

Sub.: English | Month : November

Class : I

Name _____ Sec ____

I. Fill in the blanks using the words given in the help box :-

a) The books are _____ the bag.



b) The ball is _____ the table.



c) The cat is _____ the chair.



d) The school is _____ my house.



e) The teacher is standing _____ the students.



in , in front of , on , under , near

Read the passage and answer the questions that follow :-

My Garden

I have a little garden near my house. There are many beautiful flowers in my garden. I water the plants everyday. A butterfly sits on a flower. I love my garden very much.



1. Where is the garden ?

_____



2. Who sits on a flower ?

_____



3. Do you love your garden ?

_____



III. Fill in the blanks with HAS / HAVE

1. I _____ a red ball.
2. He _____ a blue bag.
3. They _____ two books.
4. She _____ a doll.
5. We _____ a big classroom.
6. The dog _____ a long tail.



IV. Write words that go with the word 'BIRTHDAY'.



BIRTHDAY



Delhi Public School, Dhanbad

Hindi Monthly Assignment

Class -1

Name _____ Sec ___

चित्र देखकर दिए गए संयुक्त अक्षरों से शब्द बनाएं।

	क्क	
	म्म	
	प्प	
	ख्ख	
	व्व	

विशेषण

नीचे लिखे शब्दों की विशेषता बताने वाले शब्द चुनकर लिखिए-

चालाक, चौथी, मोटी, हरा-भरा, ईमानदार, चमकीले, हरा, मीठा

1. ..... लोमड़ी 
2. ..... तोता 
3. ..... पुस्तक 
4. ..... आम 
5. ..... मैदान 
6. ..... तारे 
7. ..... लड़का 
8. ..... कक्षा 

अपठित गद्यांश

नीचे लिखे गद्यांश को ध्यान से पढ़कर प्रश्नों के उत्तर लिखिए–



एक घने जंगल में एक शक्तिशाली हाथी रहता था। वह बहुत ज़िद्दी था । जंगल के सभी जानवर हाथी से डरते थे। गीदड़ तो उससे बहुत परेशान थे, क्योंकि उनके बच्चे हाथी के पाँव के नीचे कुचले जाते थे। वे हमेशा यही सोचते थे कि किसी तरह यह हाथी मर जाए तो उनके बच्चों के जीवन की रक्षा हो सके।

क) एक घने जंगल में कौन रहता था?

_____

_____

ख) हाथी से कौन डरता था?

_____

_____

ग) गीदड़ के बच्चे किसके पाँव के नीचे कुचले जाते थे?

_____

_____

_____

घ) सही शब्द पर गोला लगाइए–

- परेशान पारेशान परशान
- कुचले कूचले कुचाले

Delhi Public School

November Maths Monthly Assignment

Class - 1

SERVICE BEFORE SELF

Name : _____ Section : _____

Write these repeated additions as multiplication.

1. $7 + 7 + 7 + 7 = \square \times \square$
2. $5 + 5 + 5 + 5 + 5 + 5 = \square \times \square$
3. $2 + 2 + 2 + 2 + 2 + 2 = \square \times \square$
4. $3 + 3 + 3 + 3 + 3 = \square \times \square$
5. $4 + 4 + 4 + 4 + 4 = \square \times \square$
6. $1 + 1 + 1 + 1 + 1 + 1 + 1 + 1 = \square \times \square$
7. $8 + 8 = \square \times \square$
8. $6 + 6 + 6 = \square \times \square$
9. $5 + 5 + 5 + 5 = \square \times \square$
10. $1 + 1 + 1 = \square \times \square$
11. $9 + 9 + 9 + 9 + 9 = \square \times \square$
12. $8 + 8 + 8 + 8 = \square \times \square$
13. $7 + 7 + 7 = \square \times \square$
14. $3 + 3 + 3 + 3 + 3 + 3 + 3 + 3 + 3 + 3 = \square \times \square$
15. $10 + 10 + 10 = \square \times \square$



Multiplication as Repeated Addition



___ x ___ = ___

___ + ___ + ___ + ___ = _____



___ x ___ = ___

___ + ___ + ___ + ___ = _____



___ x ___ = ___

___ + ___ + ___ + ___ + ___ = _____



___ x ___ = ___

____ + ____ + ____ = _____



___ x ___ = ___

___ + ___ + ___ + ___ + ___ + ___ = _____



___ x ___ = ___

_____ + ___ = _____

Directions: Hop up the number to find the product (answer). Write your answer on the blank space.

1. 7 x 4 = _____

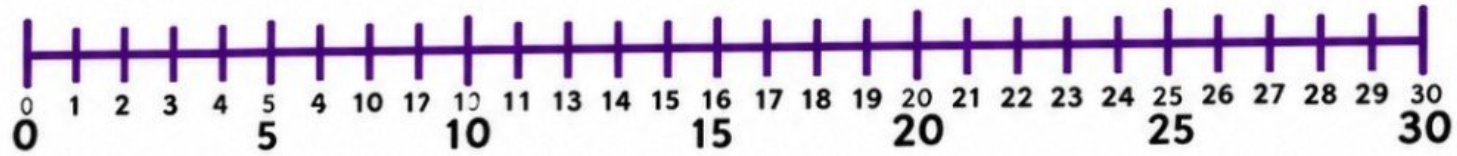

2. 5 x 5 = _____

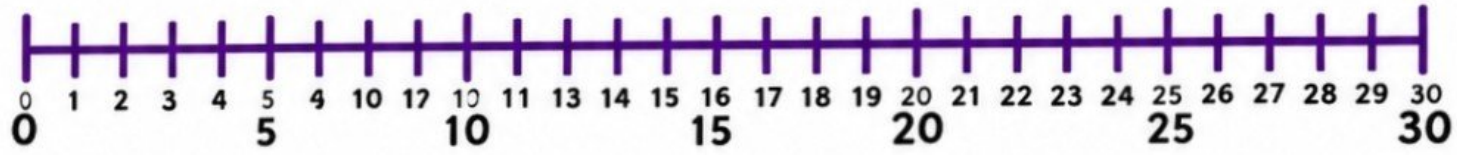

3. 11 x 2 = _____

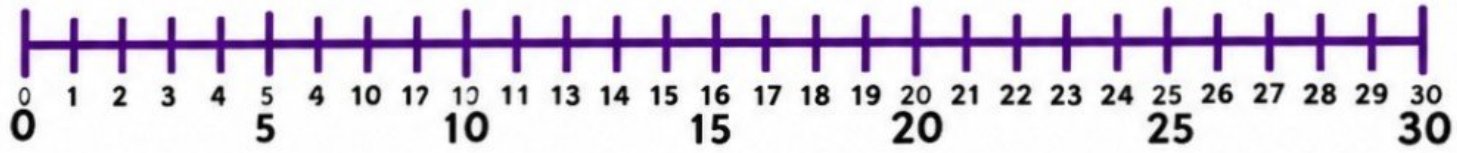

4. 3 x 10 = _____

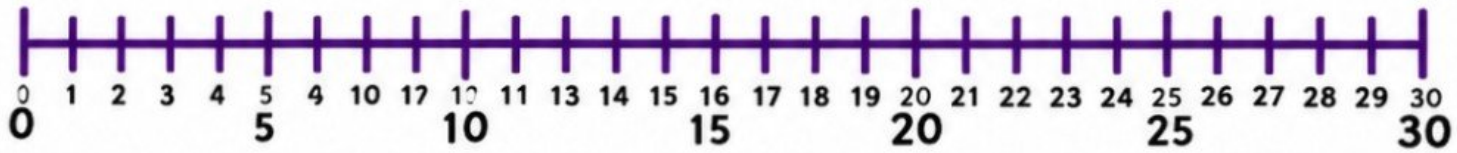

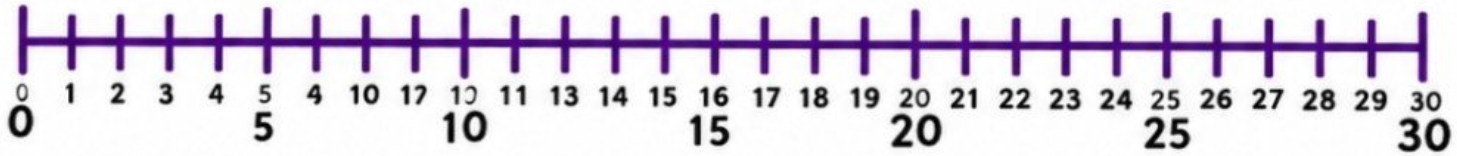

DELHI PUBLIC SCHOOL
November EVS Monthly Assignment
Class - 1

Name _____ Sec _____

A Write the correct type of transport -

1. Bus - _____
2. Ship - _____
3. Aeroplane - _____

B Tick (✓) the correct answer.

1. Which transport flies in the sky ?
   - ○ Bus
   - ○ Aeroplane
   - ○ Train
2. Which transport moves on water ?
   - ○ Boat
   - ○ Car
   - ○ Bicycle

C Write T for True and F for False.

1. A bicycle causes air pollution. ☐
2. A train runs on tracks. ☐
3. We should play on the road. ☐
4. A ship carries people and goods on water. ☐

D) Fill in the Blanks

Use these words : Zebra crossing , Wet hands, stranger , stop , pavement.

1. Always walk on the _____ when walking beside a road.
2. Cross the road only at a _____.
3. A red traffic light means _____.
4. Never touch electric switches with _____.
5. Do not talk to or take food from a _____.

E) Draw and colour a Traffic Light in the box below and label what each colour says (STOP, WAIT, GO).

DELHI PUBLIC SCHOOL, DHANBAD

COMPUTER MONTHLY ASSIGNMENT – NOVEMBER 2026



Class: I **Name:** _____ **Sec.:** _____

I. Fill in the Blanks

A. How to Start a Computer

Word Bank: electricity, UPS, Monitor, CPU, Desktop



1. First, switch on the _____ for the computer.
2. Next, switch on the _____.
3. Then, switch on the _____.
4. After that, switch on the _____.
5. Finally, the _____ appears on the monitor.

B. How to Shut Down a Computer

Word Bank: Start Button, Power, Shut Down, Monitor, UPS, Power Switch



1. Click on the _____ on the desktop with the mouse.
2. Click on _____.
3. Then click on _____.
4. Switch off the _____.
5. Switch off the _____.
6. Finally, switch off the _____.

II. One Word Answer Questions



1. Where should you remove your shoes before entering the computer lab?
   Ans. : _____
2. How should you enter the computer lab?
   Ans. : _____
3. What should you keep flat on the ground and at the same level as the keyboard while sitting?
   Ans. : _____
4. How should you sit while using a computer?
   Ans. : _____
5. What should you not bring into the computer lab?
   Ans. : _____



III. True or False

Write T for True and F for False.

1. We should remove our shoes before entering the computer lab. ☐
2. We should talk loudly in the computer lab. ☐
3. We should eat and drink near the computer. ☐
4. We should keep a proper distance from the monitor. ☐
5. We should hit the keyboard and mouse hard. ☐



Delhi Public School, Dhanbad

Name-_____ | Sec-___ | Subject- Drawing
Month- November

Colour the picture



Trace and Colour the Rangoli

Trace the dotted rangoli, then colour it!



Draw and colour any one of your favourite cartoon characters.

