DELHI PUBLIC SCHOOL DHANBAD

MONTHLY ASSIGNMENT (NOVEMBER 2026)

CLASS – 2

SUBJECT- HINDI

NAME : ---------- **SEC :** ----------

1. नीचे दी गई कविता की पंक्तियों को सही शब्द लिखकर पूरा कीजिए :–

क. मीठा होता खस्ता .....

ख. मीठे होते आम .....

ग. मीठा होता सर का .....

घ. सबसे मीठे, मीठे .....

2. निम्नलिखित वाक्यों में सर्वनाम शब्दों को रेखांकित कीजिए :–

क. मैं रोज स्कूल जाता हूँ।

.....

ख. वह मेरी बहन है।

.....

ग. तुम कहाँ जा रहे हो।

.....

घ. हम सब मिलकर खेलते हैं।

.....

ड. यह मेरा खिलौना है।

.....

3. दिए गए सर्वनाम शब्दों से वाक्य बनाइए।

क. मैं –.....

ख. तुम – .....

ग. वह –.....

घ. हम – .....

ड. यह – .....

4. नीचे दिए गए शब्दों के अर्थ लिखिए :–

क. नन्हीं –.....

ख. ऊँचा – .....

ग. न्यारी – .....

घ. दाख – .....

ड. अनमोल – .....

5. दिए गए चित्र में रंग भरें :–



DELHI PUBLIC SCHOOL, DHANBAD

ENGLISH ASSIGNMENT [NOVEMBER 2026]

STD-II

Name:_____ Sec:_____

1) Match each word to its synonym.

big	speedy
pretty	little
happy	large
small	damp
fast	begin
start	glad
also	beautiful
wet	too

2) Use a word from the word box below to make a compound word. Use the pictures as clues.

cake	paste	robe	paper	berry	ball	plane

a. news + _____ = _____

b. pan + _____ = _____

c. bath + _____ = _____

d. air + _____ = _____

e. straw + _____ = _____

f. tooth + _____ = _____

g. basket + _____ = _____










3) Write the opposite of each word given below:

a) new = _____

b) pretty = _____

c) left = _____

d) top = _____

e) under = _____

f) open = _____

g) tall = _____

h) slow = _____

4) Join the dots and colour the picture

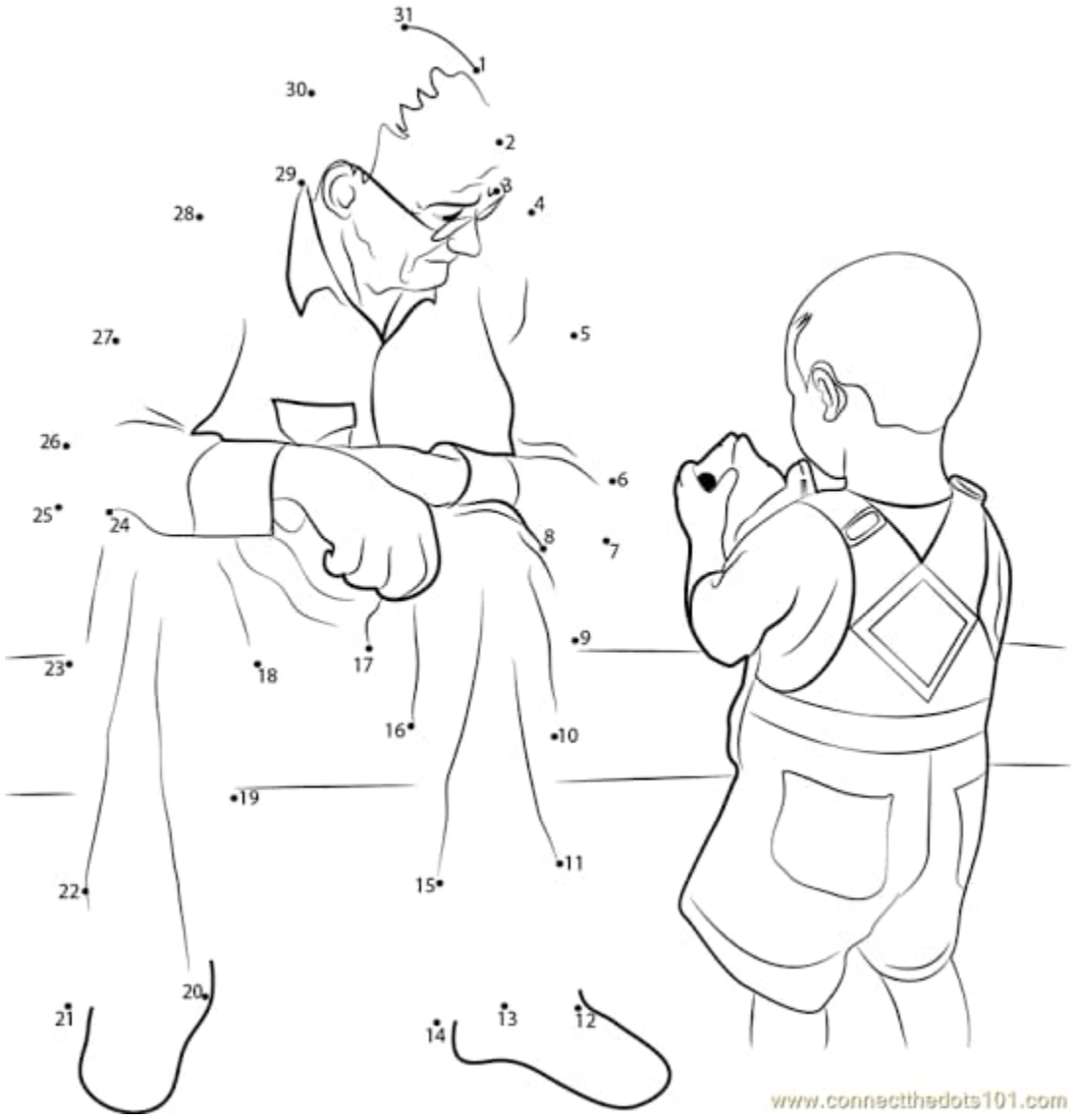

Delhi Public School

Monthly Assignment of November, 2026

Std - II **Subject - Maths**

Name: _____ **Roll No:** _____ **Date:** _____

Q1) Write the name of these flat shapes.



Name: .....



Name: .....

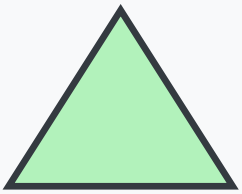

Name: .....

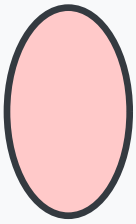

Name: .....



Name: .....



Name: .....

Q2) See the letters and count the number of lines they have :-

A
Straight lines .....
Curved lines .....

B
Straight lines .....
Curved lines .....

U
Straight lines .....
Curved lines .....

O
Straight lines .....
Curved lines .....

D
Straight lines .....
Curved lines .....

V
Straight lines .....
Curved lines .....

Q3) Write the table of 13 and 14.

Delhi Public School Dhanbad

Monthly Assignment – November 26

Class 2 – EVS

Topic: Animals Are Useful to Us



Name: _____ Class: 2 Date: _____

Q1. Fill in the blanks using the help box.

Help Box : Milk, Silk, Honey, Wool, Meat



a) We get _____ from cows and buffaloes.
b) We get _____ from sheep.
c) We get _____ from silkworms.
d) Bees give us _____.
e) We get _____ from goats and hens.

Q2. Fill in the correct animal name.



a) I plough the field. I am a _____.
b) I carry loads. I am a _____.
c) I bring logs of wood from the forest. I am an _____.
d) The bridegroom rides on me. I am a _____.
e) I make the soil fertile for crops. I am an _____.

Q3. Give two examples of each.



a) Animals that give milk: _____, _____
b) Animals that lay eggs: _____, _____
c) Animals that carry loads: _____, _____
d) Animals that give us fibre: _____, _____

Q4. Think and Answer.



a) You see a badly hurt cat on the road. What will you do?

_____

b) Do you think we should use things made of leather? Why?

_____

_____

MONTHLY ASSIGNMENT - NOVEMBER, 2026

Air ALL Around Us

MULTIPLE CHOICE QUESTIONS

TICK THE CORRECT OPTION (✓)

1. Moving air is called
   ☐ Breeze ☐ Wind ☐ Storm
2. Which of these can make air dirty?
   ☐ Plants ☐ Vehicles ☐ Rain
3. A gentle wind is called
   ☐ Storm ☐ Breeze ☐ Hurricane
4. To keep the air clean, we should
   ☐ Burn garbage
   ☐ Plant more trees
   ☐ Cut trees

DRAW & COLOR A PINWHEEL

My Pinwheel Drawing

OBSERVE THE EXPERIMENT & LEARN



What does this experiment prove?
Air has _____ (WEIGHT)

Which balloon is heavier?
The _____ one. (INFLATED)

How can we keep the air around us clean? Name three ways.

SHORT ANSWER

How can we keep the air around us clean? Name two ways.

Way 1: _____

Way 2: _____

Way 3: _____

DELHI PUBLIC SCHOOL , DHANBAD

MONTHLY COMPUTER ASSIGNMENT (NOVEMBER 2026)

1. CHOOSE THE CORRECT ANSWER

1) Which of these is an input device?

☐ a) Printer ☐ b) Keyboard ☐ c) Monitor

2) The brain of the computer is the ___.

☐ a) Mouse ☐ b) CPU ☐ c) Monitor

3) Which of these is an output device?

☐ a) Monitor ☐ b) Keyboard ☐ c) Mouse

4) Which of these is NOT a part of a computer?

☐ a) Scanner ☐ b) Eraser ☐ c) Printer

2. WRITE T FOR TRUE AND F FOR FALSE

a) We use a mouse to type. ☐

b) The printer gives output on paper. ☐

c) Keyboard helps us to give input. ☐

d) The CPU is also called the brain of the computer. ☐

e) We cannot see anything on the monitor. ☐

3. MATCH THE FOLLOWING

COLUMN A	**COLUMN B**
1. Keyboard	A. To look at the work on screen
2. Mouse	B. To scan pictures and documents
3. Monitor	C. To type letters and numbers
4. Printer	D. To take printouts on paper
5. Scanner	E. To click and select items

Remember: Practice makes you a Computer Smart Kid…… Be smart. Use computers with care.